# July 2019

| Sun | Mon | Tues | Wed | Thurs | Fri | Sat |
|---|---|---|---|---|---|---|
| | *1*<br>Mary has 36 books. If she has read 14 of them, how many of them does she have left to read? | *2*<br>How many tens are in the following number? How many ones?<br>45 | *3*<br>There are 4 students sharing 5 brownies. How much does each person get if they share them equally? | *4*<br> <br>*Happy 4th of July!* | *5*<br>34 - 17= | *6*<br>Using the digits<br>7, 5, 9<br>Write the greatest number and the smallest number. |
| *7*<br> <br> | *8*<br>What is the value of the 2 in each number?<br>1.) 125<br>2.) 217<br>3.) 12 | *9*<br>Solve.<br>6+6 =<br>7+6 = | *10*<br>How can you use 6+4=10 to help you solve 10-6=?<br>**EXPLAIN!!!** | *11*<br>10=__+ 3 | *12*<br>How many stickers is one-half?<br> | *13*<br>Find the sum of 53 and 61. |
| *14*<br> | *15*<br>Find 3 examples of each of the following 3D shapes:<br>Cube<br>Sphere<br>Cone | *16*<br>Round **87** to the nearest ten. | *17*<br>Write an addition story problem using any numbers you choose. | *18*<br>Show 4:15<br>  | *19*<br>Complete the fact family:<br>6 + 5 = 11<br>_____<br>_____<br>_____ | *20*<br>I have 3 quarters, 1 dime, 3 pennies. How much money do I have? |
| *21*<br> <br> | *22*<br>Name a fraction that is greater than $\frac{1}{2}$.<br>Explain! | *23*<br>14 -7= _ | *24*<br>What does it mean if $\frac{4}{4}$ of the coins in my pocket are dimes? | *25*<br>Find the difference of 86 and 19. | *26*<br>Write an addition/ subtraction fact family using any numbers you choose. | *27*<br>How many **vertices** does this 3D shape have?<br> |
| *28*<br> | *29*<br>How can you use 8+8 to help you solve 9+8 ?<br>**EXPLAIN!!!** | *30*<br>Draw 20 stars. How many groups of 5 can you make? | *31*<br>Skip count by 4's as high as you can. Make a list. | | | |

# August 2019

| Sun | Mon | Tues | Wed | Thurs | Fri | Sat |
|---|---|---|---|---|---|---|
| | | | | *1*<br>Write 3 numbers that round to 40. | *2*<br>Show 8:45 on the clock.<br>  | *3*<br>Fill in the missing number.<br><br>83, 87, ___, 95, 99 |
| *4*<br> | *5*<br>There are 24 crackers. The teacher passes out 18 for snack. How many crackers are left ? | *6*<br>48 + 12 = | *7* What fraction of the bones are in the bowl?<br> | *8*<br>Write a story problem using the numbers 26 and 14. | *9*<br>The library had 3,500 books. It received a shipment of 1,432 books. How many books does the library have now? | *10*<br>Draw a line of symmetry on the figure.<br> 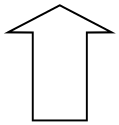 |
| *11*<br> | *12*<br>Draw a set of hearts that shows one-fourth of the hearts are red. | *13*<br>Write an addition and subtraction fact family with any numbers you choose. | *14*<br>  <br>Odd or even?<br>Explain. | *15*<br><u>Prove/Explain</u> which fraction is greater:<br>$\frac{1}{2}$ OR $\frac{1}{4}$ | *16*<br>What is the date of the first Saturday in August? | *17*<br>60 - 15 = |
| *18*<br> | *19*<br>Find the difference between 63 and 50. | *20*<br>Kim bought an ice cream cone for $0.70 She paid with 1 dollar bill. How much money should she get back? | *21*<br> <br>What is the core of the pattern?<br>What comes next? | *22*<br>Write the number.<br>  | *23*<br>Count forward by tens to 103 starting at 53. | *24*<br>What month comes **before** April? |
| *25*<br>***First Day of School is on August 26!***<br><br>***Calendars are due on Aug. 30*** | *26*<br>Write the number that is ten more and ten less than the number below.<br> 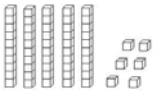 | *27*<br>What is the date of the third Tuesday in this month of August? | *28*<br><u>Prove/Explain</u> which number is greater.<br><br>**235 OR 253** | *29* Make a spinner where the color blue would be most likely to win.<br> 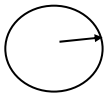 | *30*<br>Fill in the blank with the correct symbol. <,>,=.<br>8+2 ☐ 9+1 | *31*<br>Finish the pattern and write the rule.<br>14, 16, 18, 20, ___, ____. ___ |